Выполните технический рисунок

Начертите технические рисунки деталей, три вида которых имеют **один** и тот же вид?



1

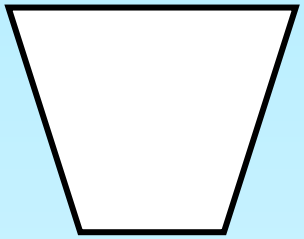

2

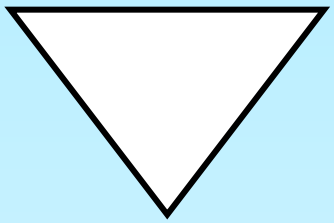

3

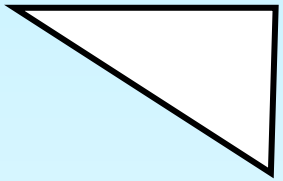

4

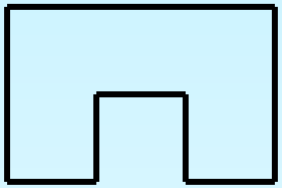

5

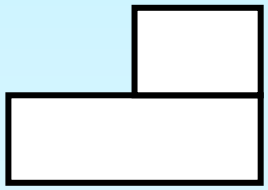

6